Solving Linear Inequalities
(One Variable)

Level 1 - Solve and graph simple linear inequalities
Level 2 - Solve and graph multi-step inequalities
Level 3 - Solve and graph compound inequalities

Answers:

Level 1

a)	b) 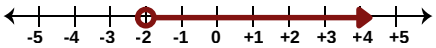
c) 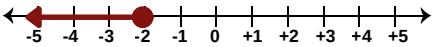	d) 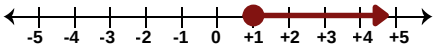
e) 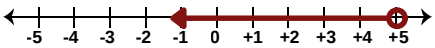	f) 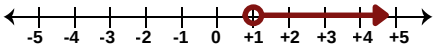
g) 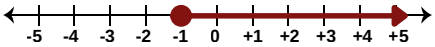	h) 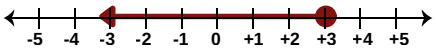
i) 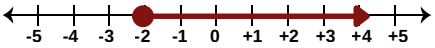	j) 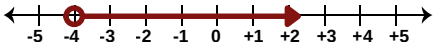

k) $x \geq 0$	**l)** $x \leq 4$
m) $x > -3$	**n)** $x < 1$
o) $x \leq 0$	**p)** $x \geq 1$
q) $x \geq -5$	**r)** $x < 5$
s) $x < -2$	**t)** $x > 0$

Level 2

a)	b) 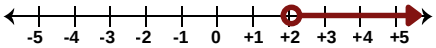
c) 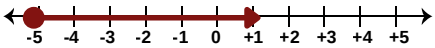	d) 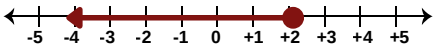
e) 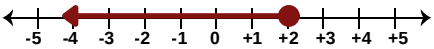	f) 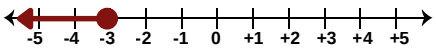
g) 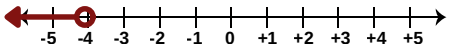	h) 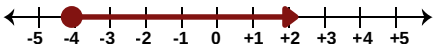
i) 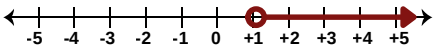	j) 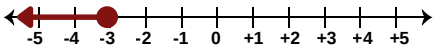
k) 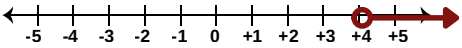	l) 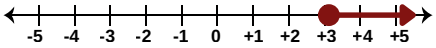
m) 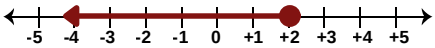	n) 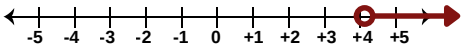
o) 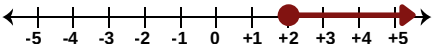	p) 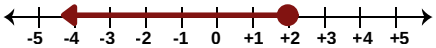

Level 3

a) 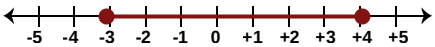	b) 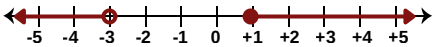
c) 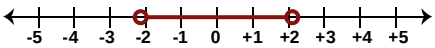	d) 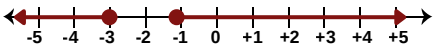
e) 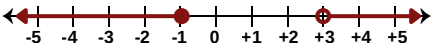	f) 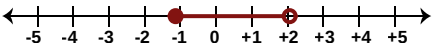
g) 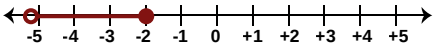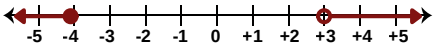	h)